Bruchteile

1. Bestimme den Teil der Fläche, der grau eingefärbt ist.

a)

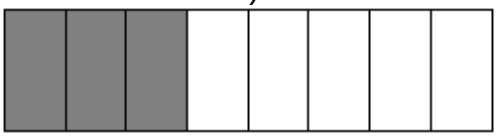

b)



2. Bestimme den Teil der Fläche, der grau eingefärbt ist.

a)



b)

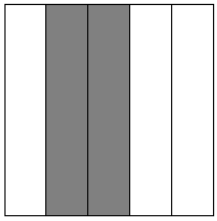

c)



d)



3. Bestimme den Teil der Fläche, der grau eingefärbt ist.

a)

b)

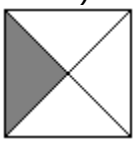

c)

d)

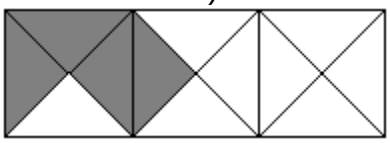

4. Bestimme den Teil der Fläche, der grau eingefärbt ist.

a)

b)

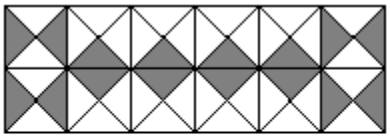

c)

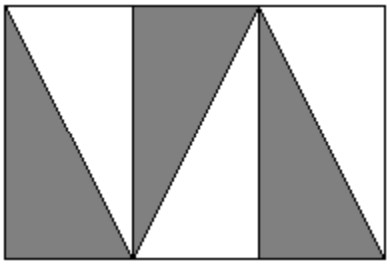

5. Bestimme den Teil der Fläche, der grau eingefärbt ist.

a)

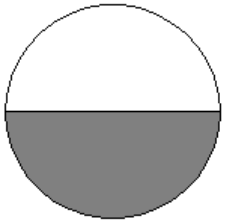

b)

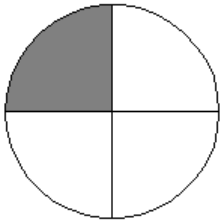

c)

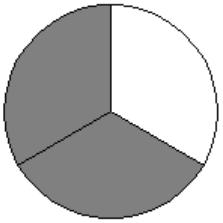

6. Bestimme den Teil der Fläche, der grau eingefärbt ist.

a)

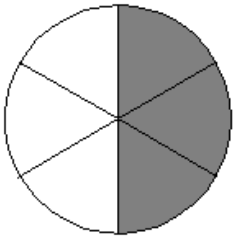

b)

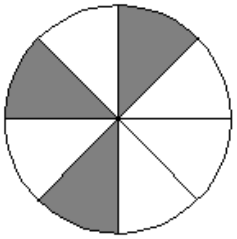

c)

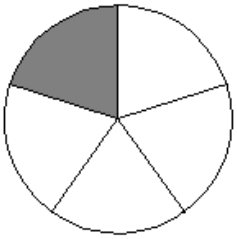

7. Bestimme den Teil der Fläche, der grau eingefärbt ist.

a)

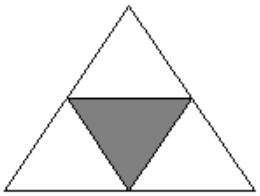

b)

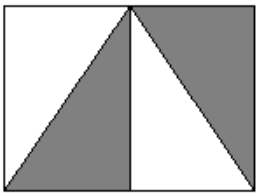

c)

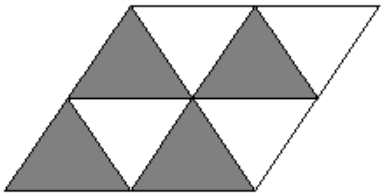

d)

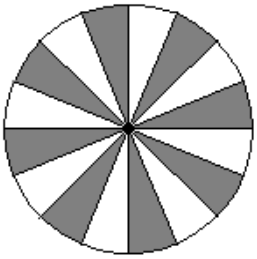

e)

f)



g)

h)

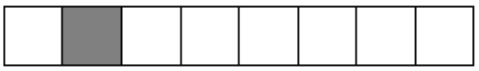

8. Bestimme den Teil der Fläche, der grau eingefärbt ist.

a)



b)



c)

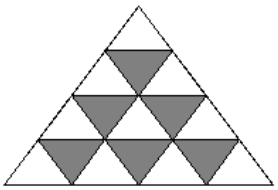

d)

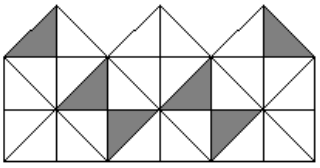
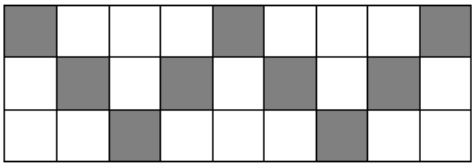
e)